

Mathématiques

Défi 10
CE1

Date .....

A Calcul

104 + 357 + 56 =

563 + 42 + 235 =

99 – 35 =

Pose les additions en colonne, puis calcule.

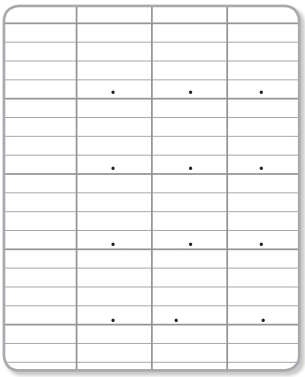

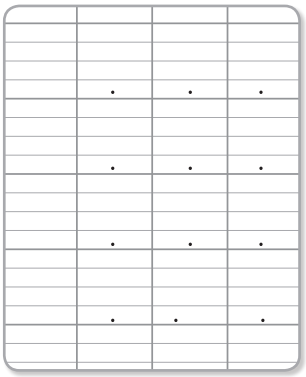

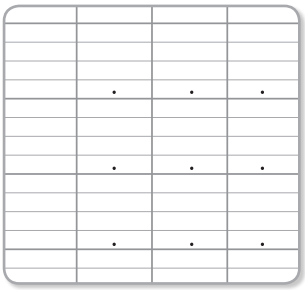



B Numération • Compte de 10 en 10 à partir du nombre indiqué.

308							
425							
564							
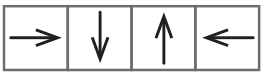
C Géométrie • Code le parcours de Robotine.